Name _____ Date _____

Equal groups: bags and rows

Count the dots. Fill in the boxes.

1. 

☐ bags of ☐ = ☐

2. 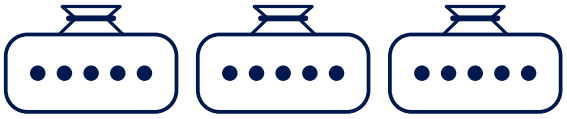

☐ bags of ☐ = ☐

3. 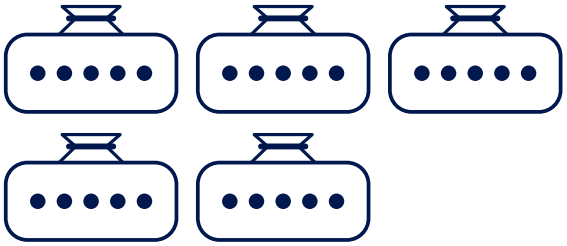

☐ bags of ☐ = ☐

4. 

☐ bags of ☐ = ☐

5. 

☐ rows × ☐ in each row = ☐

6. 

☐ rows × ☐ in each row = ☐

7. 

☐ rows × ☐ in each row = ☐

8. 

☐ rows × ☐ in each row = ☐

Your child got _____ out of 8 right.

© 2026 Play Smart Games Limited · free for home and classroom use, not for sale or republishing · ukschoolprep.com

Answers

1. **4** bags of **2** = **8**
2. **3** bags of **5** = **15**
3. **5** bags of **5** = **25**
4. **3** bags of **10** = **30**
5. **3** × **2** = **6**
6. **2** × **5** = **10**
7. **4** × **10** = **40**
8. **4** × **5** = **20**

For the grown-up

- Count the bags first, then the dots in one bag, then count in 2s, 5s or 10s to find the total.
- The small words under the boxes say which number goes where: the rows first, then how many in each row.
- If your child writes 5 × 4 for 4 rows of 5, the total is still right. Say so, then show that on this sheet the rows come first.
- Next, say the 2, 5 and 10 times tables aloud together, using the pictures to check.

In the app: **“Arrays and groups”** is free in **7+ Maths** for Android phones and tablets, with every level. This sheet and more like it:
ukschoolprep.com/worksheets/equal-groups-and-multiplication/

© 2026 Play Smart Games Limited. Free to print and use at home with your own children, and by teachers and tutors with their own pupils. You may not sell it, republish it online or in print, or include it in any pack, course, product or service offered to others. To share it, please link to this page. From 7+ Maths, an independent app; not affiliated with any school.