Name _____ Date _____

Hundreds, tens and ones

Count the hundreds, tens and ones. Write the missing numbers.

1. 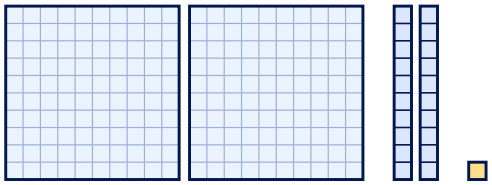 = ☐

2. 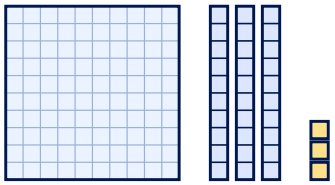 = ☐

3. 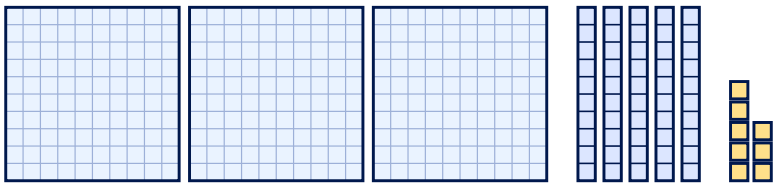 = ☐

4. 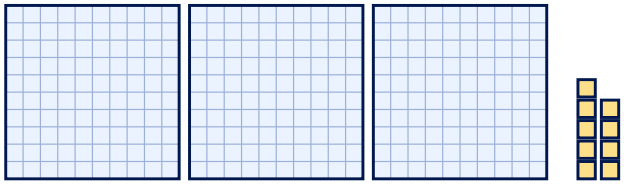 = ☐

5. 6 hundreds, 4 tens and 1 one = ☐

6. 983 = 9 hundreds, ☐ tens and 3 ones

7. 273 = ☐ hundreds, 7 tens and 3 ones

8. 794 = 700 + ☐ + 4

9. The 1 in 316 is worth ☐

Your child got _____ out of 9 right.

© 2026 Play Smart Games Limited · free for home and classroom use, not for sale or republishing · ukschoolprep.com

Answers

1. **221** (2 hundreds, 2 tens, 1 one)
2. **133** (1 hundred, 3 tens, 3 ones)
3. **358** (3 hundreds, 5 tens, 8 ones)
4. **309** (3 hundreds, 0 tens, 9 ones)
5. 6 hundreds, 4 tens and 1 one = **641**
6. 983 = 9 hundreds, **8** tens and 3 ones
7. 273 = **2** hundreds, 7 tens and 3 ones
8. 794 = 700 + **90** + 4
9. The 1 in 316 is worth **10**

For the grown-up

- Count the hundreds first, then the tens, then the ones, and say the number aloud before writing it.
- Zero matters: 3 hundreds and 8 ones is 308, not 38. An empty place still needs its 0.
- For ‘the 6 in 462 is worth ?’, ask which place the 6 is in. It is in the tens, so it is worth 60.
- If numbers over 100 are new to your child, do the tens and ones sheet first.

In the app: **“Tens and ones”** is free in **7+ Maths** for Android phones and tablets, with every level. This sheet and more like it: ukschoolprep.com/worksheets/hundreds-tens-and-ones-to-999/

© 2026 Play Smart Games Limited. Free to print and use at home with your own children, and by teachers and tutors with their own pupils. You may not sell it, republish it online or in print, or include it in any pack, course, product or service offered to others. To share it, please link to this page. From 7+ Maths, an independent app; not affiliated with any school.