Name _____ Date _____

Tens and ones

Count the tens and ones. Write the missing numbers.

1. 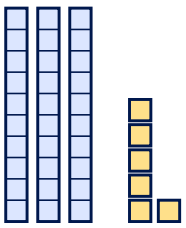 = ☐

2. 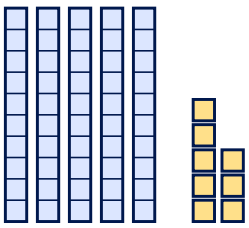 = ☐

3. 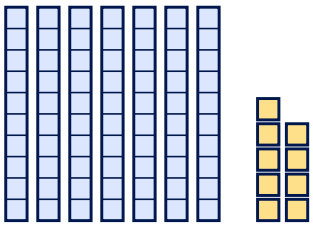 = ☐

4. 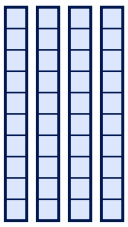 = ☐

5. 6 tens and 7 ones = ☐

6. 83 = ☐ tens and 3 ones

7. 97 = 9 tens and ☐ ones

8. 25 = 20 + ☐

9. 69 = ☐ + 9

10. The 5 in 56 is worth ☐

Your child got _____ out of 10 right.

© 2026 Play Smart Games Limited · free for home and classroom use, not for sale or republishing · ukschoolprep.com

Answers

1. **36** (3 tens, 6 ones)
2. **58** (5 tens, 8 ones)
3. **79** (7 tens, 9 ones)
4. **40** (4 tens, 0 ones)
5. 6 tens and 7 ones = **67**
6. 83 = **8** tens and 3 ones
7. 97 = 9 tens and **7** ones
8. 25 = 20 + **5**
9. 69 = **60** + 9
10. The 5 in 56 is worth **50**

For the grown-up

- Real things help: bundle ten straws or pencils with an elastic band, and let your child build the numbers.
- If they are stuck on a picture, count the rods in tens (10, 20, 30), then count on the cubes.
- A common slip is writing the digits the wrong way round, 63 for 36. Ask: how many tens? That digit comes first.
- When this feels easy, try the hundreds, tens and ones sheet.

In the app: **“Tens and ones”** is free in **7+ Maths** for Android phones and tablets, with every level. This sheet and more like it:
ukschoolprep.com/worksheets/tens-and-ones-to-99/

© 2026 Play Smart Games Limited. Free to print and use at home with your own children, and by teachers and tutors with their own pupils. You may not sell it, republish it online or in print, or include it in any pack, course, product or service offered to others. To share it, please link to this page. From 7+ Maths, an independent app; not affiliated with any school.